Matheus Dupervil

Exit Ticket

How many more carrots are there than potatoes?

They 4-2=2 more

I use carrots

How many carrots and corn are there in all?

4+3=7

I use the tenfrim

Angebertrai February 11 2026

Exit Ticket

How many more carrots are there than potatoes?

2 more carrot than potatoes

4-2=2

How many carrots and corn are there in all?

4+3=7

Cedric Frenel February 11, 2026

Exit Ticket

How many more carrots are there than potatoes?

2 More

4 - 2 = 2

How many carrots and corn are there in all?

4 + 3 = 7

0000 + 000

Name Miguely Class

Picture Graph

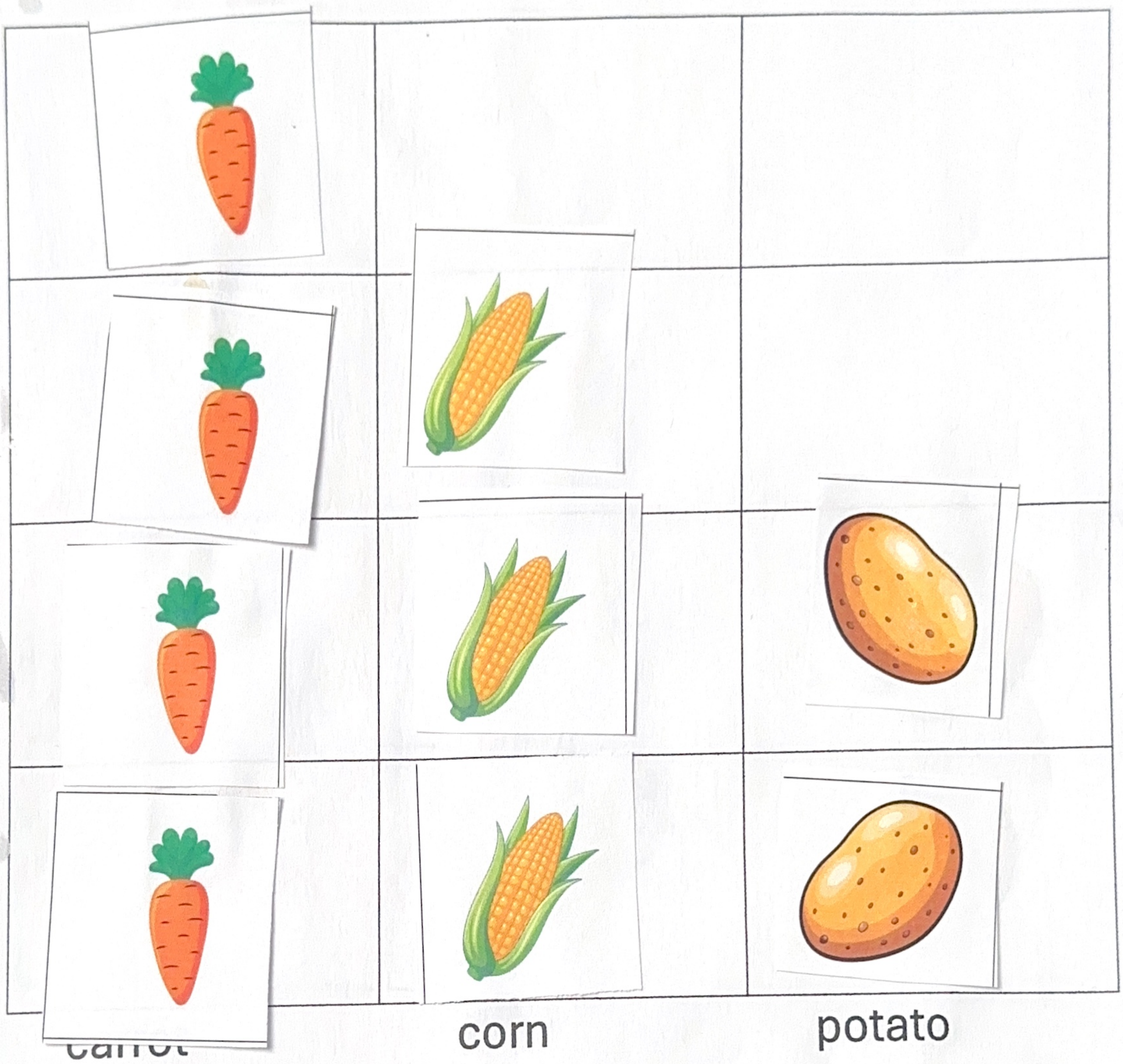

4+3+2=9

Name Ashael Kens Calixte Class 2G6

Picture Graph



4 + 3 + 2 = 9

Name Darni Rochez Class 2 6 6

Picture Graph



4+3+2=9

Name Zamyan Class

Picture Graph

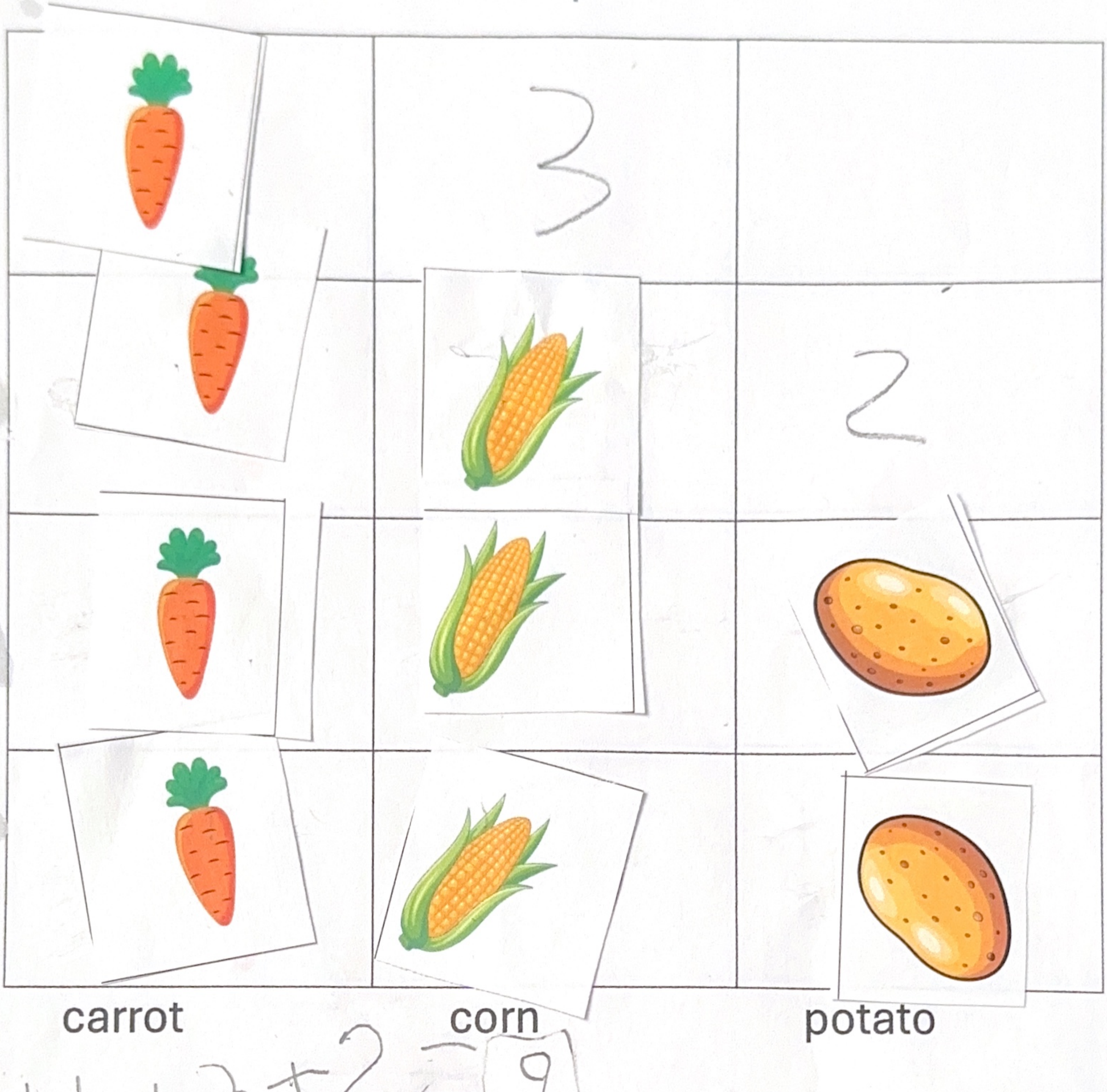

4+3+2=9

□□□□+△□△+□□

Name Matheus Duperval Februcif Class 11

Picture Graph



4+3+2=9

4+2+3=

Name Makai Raper Class 2B6

Picture Graph



4+3+2=9

4+2+3=9